# Mathematics and EVS · Sample of every question type and picture layout

Practice sheet · Difficulty: Mixed · Paper SAMPLE

| Name | Date | Score |
|---|---|---|
| | | |

Read each question slowly. A grown-up may read it aloud.
Write your answer on the line or in the box, tick the right box, or draw a ring around the right picture.

---

**1.** What time does the clock show?




- ☐ A. 3 o'clock
- ☐ B. 6 o'clock
- ☐ C. 9 o'clock
- ☐ D. 12 o'clock

**2.** Use the number line. 4 + 3 = _____

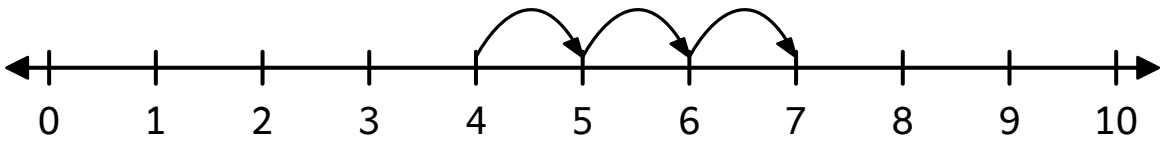

**3.** Draw a ring around the triangle.

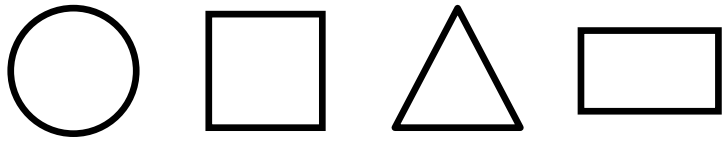

a b c d

**4.** Match each picture to its word.

1.  •
2.  •
3.  •

- A. Car
- B. Flower
- C. Apple

**5.** Group A has more balls than Group B.

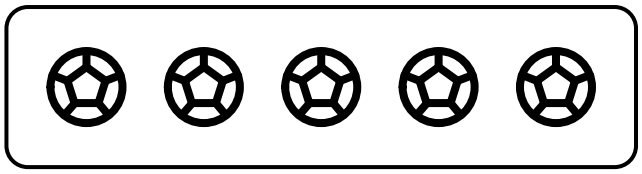

Group A

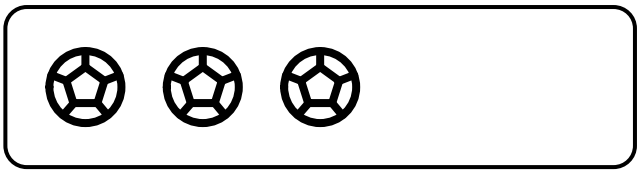

Group B

☐ T ☐ F

**6.** Count the stars. Write the number in the box.



**7.** Which one is different? Draw a ring around it.



a b c d

**8.** Name one thing we get from plants.

_____

_____

**9.** What comes next in the pattern?



☐ A. Ball ☐ B. Star

☐ C. Apple

**10.** Add the coins. Together they make ₹ _____



**₹5** **₹2** **₹1**

**11.** Find the missing part: _____

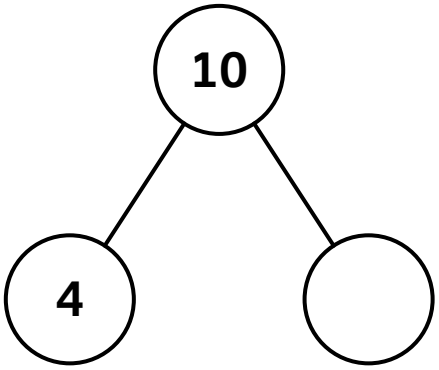


**12.** Which side is heavier?

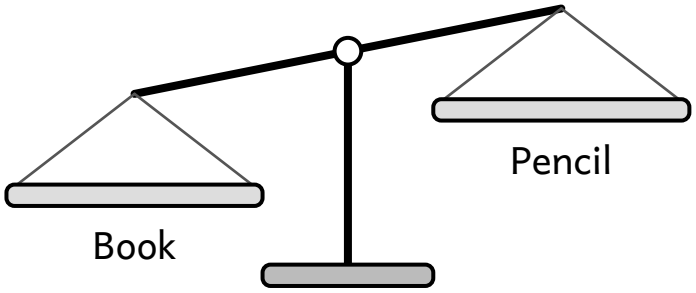


☐ A. Book

☐ B. Pencil

☐ C. Both are the same

**13.** Count the dots: _____



**14.** How many birds are left? _____



**15.** Shaded parts: _____ out of 4

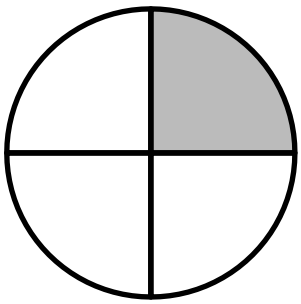

**16.** Which solid is *a ball*? _____

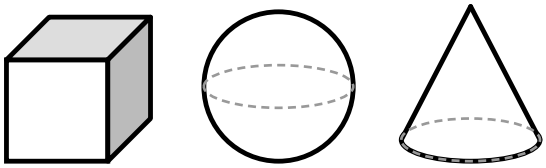

**17.** Find the missing number: _____

